2-D SHAPES 1

Review shapes.

Objects have shape and form. Simple shapes are classified according to their number of edges and points.

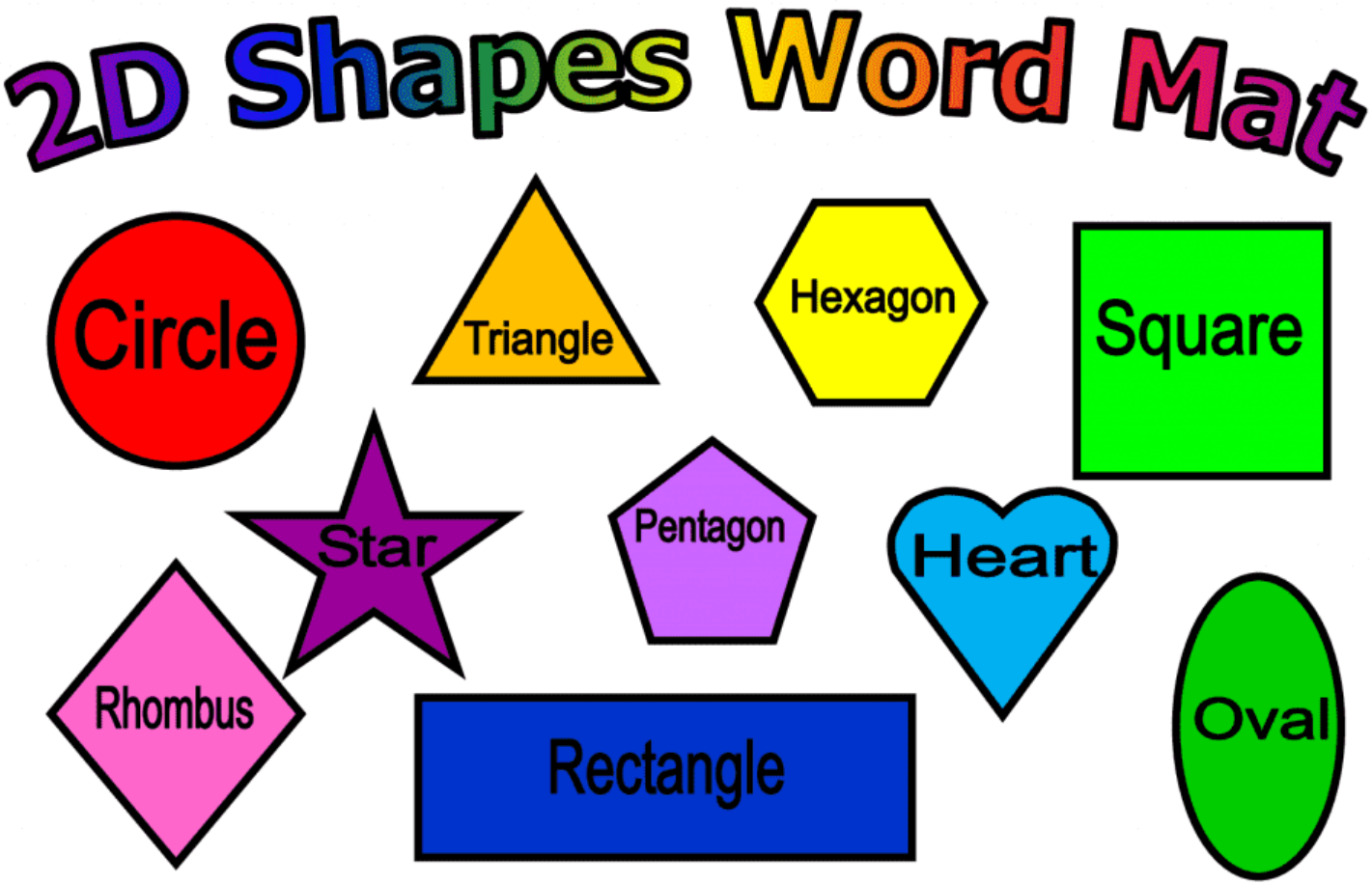

1. Type the names for these shapes.

_____ _____ _____





_____ _____ _____

2. Name the shape a croissant looks like.

☐ oval ☐ crescent ☐ circle ☐ arrow

3. Name the shape an egg looks like.

☐ circle ☐ star ☐ oval ☐ crescent

4. Name the shape a clock looks like.

☐ circle ☐ oval ☐ star ☐ crescent

5. Name the shape of this banana.

☐ crescent ☐ star ☐ circle ☐ oval

6. Which of the following shapes have NO curves?

☐ oval ☐ crescent ☐ circle ☐ star

8. Which of the following 2D shapes are concave?

- ☐ circle
- ☐ oval
- ☐ crescent
- ☐ cross

9. Which of the following shapes have square corners?

- ☐ cross
- ☐ circle
- ☐ Star
- ☐ arrow

10. Match the polygon and the number for its sides.

SORT ELEMENTS

8	triangle
6	quadrilaterals
5	pentagon
4	hexagons
3	octagons

11. Which shapes is NOT a polygon? Place an **x** over the shape?



12. How many vertices does this polygon have?



Answer = _____
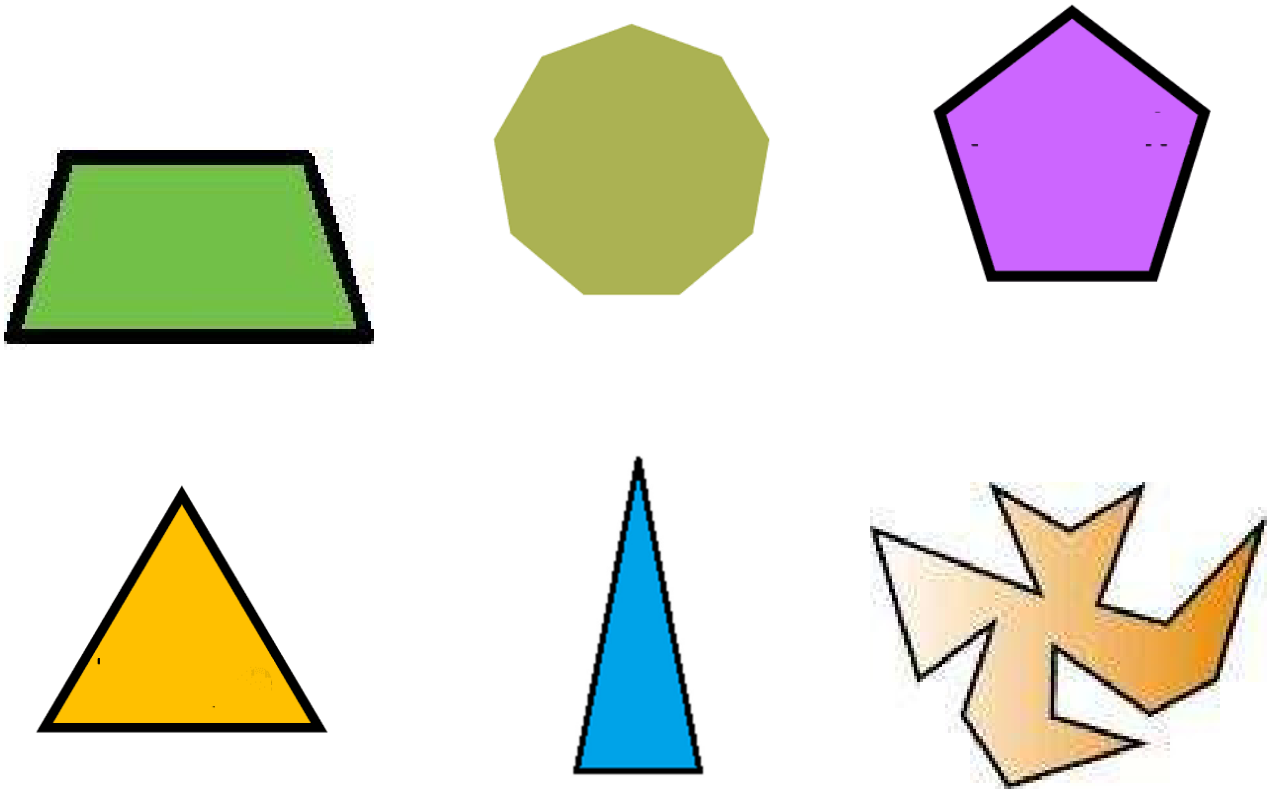
13. Indicate whether the polygons below are regular or irregular. Type "**regular**' or "**irregular**" in the space provided.